Name _____

Computation Practice #3























Name: _____

Read the Analog Clock!

Directions: Write the digital time that matches the analog clock.





















Pirate Word Search

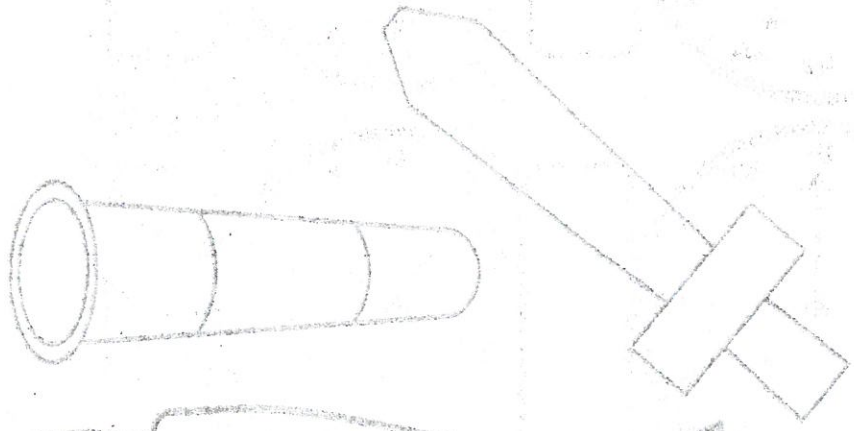

AHOY, MATEY!
Find and circle all of the words in the list below.

T	R	E	A	S	U	R	E	G	E
Y	H	W	K	C	A	N	N	O	N
P	T	A	H	Q	F	S	O	M	S
E	F	G	B	A	L	A	Z	S	W
G	E	Y	E	P	A	T	C	H	O
L	I	X	A	A	G	W	P	I	R
E	P	A	R	R	O	T	E	P	D
G	S	B	D	A	B	O	O	T	S

BEARD
TREASURE
CANNON
PARROT
BOOTS

Created by: education.com

Ice Cream Shop

Write each sentence using correct capitalization and punctuation.

do you want to go to the ice cream shop

_____

we can ride our bicycles

_____

what is your favorite flavor

_____

my favorite flavor is chocolate

_____

how many scoops do you want

_____

the ice cream is very tasty

_____

Read to Someone

1st

2nd

3rd

4th

Book Title: _____

Author: _____

Me: _____

My Buddy: _____

We give this book this many stars



©seusstastic

Missing ADDEND

a) 14 + ☐ = 47

b) 20 + ☐ = 91

c) 13 + ☐ = 124

d) 28 + ☐ = 65

e) 36 + ☐ = 86

f) 54 - ☐ = 13

g) 37 - ☐ = 25

h) 61 - ☐ = 9

i) 80 - ☐ = 11

j) 77 - ☐ = 44

Copyright © 2014 Isla Hearts Teaching

Name: _____

Read the Digital Clock!

Directions: Draw the time on the analog clock to match the digital time.



9:10



2:50



1:30



4:15



5:35



10:40



12:05



6:10



5:55



1:10

Basketball Word Search



J	U	M	P	B	D	J	H	M	A
E	Y	S	D	U	N	K	O	W	V
R	I	X	Q	O	B	L	O	C	K
S	T	J	L	F	M	W	P	C	B
E	H	S	H	O	O	T	R	F	A
Y	K	E	S	U	N	E	N	L	L
S	T	E	A	L	A	C	T	I	L
Z	P	R	E	B	O	U	N	D	U



Created by: education.com

Name _____ Date _____

Special Plural Nouns

Plural nouns refer to more than one person, place, thing, or idea. Just add -s or -es to most nouns!

But some nouns have a special plural form —

One	More than one
person	people
man	men
woman	women
child	children
tooth	teeth
mouse	mice
fish	fish

Directions: Complete each sentence. Write the plural form of the noun.

1. Three _____ built the house together. [man]

2. I brush my _____ before bed. [tooth]

3. I have toes on both of my _____ . [foot]

4. The _____ like to run around in the maze. [mouse]

5. All the _____ play outside. [child]

6. Five _____ ran a race. [woman]

7. Many _____ like music. [person]

Directions: Choose a set of words from the chart. Draw a picture of each word.

One (Word: _____)	More than one (Word: _____)

Read to Someone



1st

2nd

3rd

4th

Book Title: _____

Author: _____

Me: _____

My Buddy: _____

We give this book this many stars



©seusstastic

2nd Grade

ADDITION REGROUPING



94 + 58	85 + 37	32 + 79	55 + 62
85 + 75	98 + 73	77 + 35	76 + 81
76 + 52	61 + 79	68 + 12	49 + 44

Find worksheets, games, lessons & more at education.com/resources

Name: _____ Date: _____

Spring Coin Check-in



Write the coin's name and value below each coin.
The first one has been done for you.

 Name: _____ Value: _____	 Name: _____ Value: _____	 Name: _____ Value: _____
 Name: _____ Value: _____	 Name: _____ Value: _____	 Name: _____ Value: _____

Add the following coins:

= _____

_____ + _____ + _____ + _____ + _____ + _____ + _____

= _____

_____ + _____ + _____ + _____ + _____ + _____ + _____

Bicycle Ride



Write each sentence using correct capitalization and punctuation.

is it sunny outside today

_____

have you seen my new red bicycle

_____

i would like to ride my bicycle

_____

do you want to ride our bicycles together

_____

we can ride around the park

_____

i think it will be a lot of fun

_____

Read to Someone

Characters

Setting

Problem

Solution

Book Title: _____

Author: _____

Me: _____

My Buddy _____

We give this book this many stars



©seusstastic

Missing ADDEND

a) 14 + ☐ = 47

b) 20 + ☐ = 91

c) 13 + ☐ = 124

d) 28 + ☐ = 65

e) 36 + ☐ = 86

f) 54 - ☐ = 13

g) 37 - ☐ = 25

h) 61 - ☐ = 9

i) 80 - ☐ = 11

j) 77 - ☐ = 44

Copyright © 2014 Isla Hearts Teaching

Name: _____

Show me the TIME!



Directions: Read the words. Show the time on the analog clock AND the digital clock.

Quarter until 4

Quarter until 8

Quarter until 12

Quarter until 9



Quarter until 6

Quarter until 2

Quarter until 5

Quarter until 10



Quarter until 1



Quarter until 5

Name _____ Date _____

A or AN

Use the word A or AN in each blank space below.

REMEMBER:

Use **A** if the word begins with a **consonant** sound.

Use **AN** if the word begins with a **vowel** sound.

1. We saw_____ lion at the zoo.

2. I eat _____ apple every day.

3. Blue is _____ favorite color of mine.

4. _____ umbrella is useful for when it rains.

5. Dad and I are building _____ ramp today.

6. I have _____ red wagon.

7. Mom waited more than _____ hour in traffic.

Find worksheets, games, lessons & more at education.com/resources

My Neighborhood

Use the map of the neighborhood below to answer the questions at the bottom of the page.

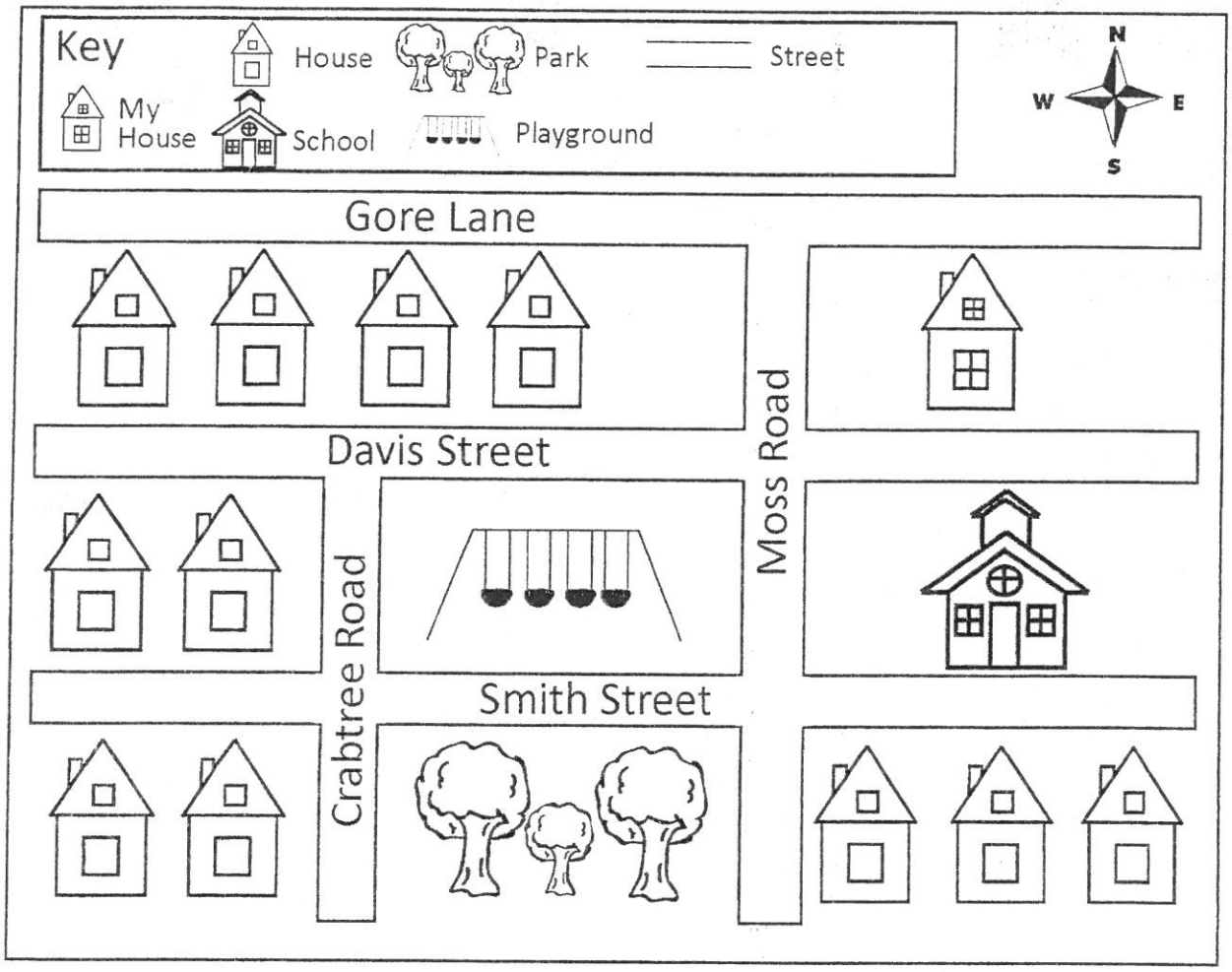

1. My house is _____ of the school. (North, South, East, or West)

2. The _____ is south of the playground.

3. To get from my house to the school, you must cross _____ Street.

4. The school is _____ of the playground. (North, South, East, or West)

5. How many houses are West of Crabtree Road? _____

6. How many house are South of Smith Street? _____

7. The playground is _____ and _____ of my house. (North, South, East, or West)

8. The school is _____ and _____ of the park. (North, South, East, or West)

Find worksheets, games, lessons & more at education.com/resources

Read to Someone

Characters

Setting

Problem

Solution

Book Title: _____

Author: _____

Me _____

My Buddy _____

We give this book this many stars



©seusstastic

Name: _____

Read the Digital Clock!

Directions: Draw the time on the analog clock to match the digital time.



8:15



3:45



4:30



5:15



1:30



11:45



2:30



12:15



4:30



6:15

Wh Words

Fill in the Blank

Fill in the blanks with one of the wh- words to make each sentense make sense.

who • what • where • when • why

- _____went with you to the park?
- The dog stood at the door wondering_____I would let him out.
- Tony was the only student_____got an A on the math test.
- _____is your favorite color?
- The driver_____was lost asked_____Bradley Street was.
- The plumber couldn't figure out_____the faucet wasn't working.
- _____is your house?
- Soccer is a great sport for people_____can run fast.
- _____the bus arrived, Stacy asked the driver_____the bus was going.
- Mr. Thomas wants to know_____the market is.
- _____time is it?
- _____is the first thing you do_____you come home from school?

Name _____ Date _____



Reading Calendar Days and Dates

March 2020

Answer the following questions using the calendar below.

1. What day on the calendar is March 12?

_____

2. How many Tuesdays are there in March?

_____

3. St. Patrick's Day is March 17. Write the day.

_____

4. Ben has a basketball game every Monday. Write the date of his last game in March.

_____

5. The first day of spring is the 20th day of March. Write it two ways.

_____

Sunday	Monday	Tuesday	Wednesday	Thursday	Friday	Saturday
1	2	3	4	5	6	7
8	9	10	11	12	13	14
15	16	17	18	19	20	21
22	23	24	25	26	27	28
29	30	31				

Read to Someone

Characters

Setting

Problem

Solution

Book Title: _____

Author: _____

Me: _____

My Buddy: _____

We give this book this many stars



©seusstastic

Name: _____

Read the Analog Clock!

Directions: Write the digital time that matches the analog clock.





















Name:_____

Quantity Discrimination #4

Directions: Choose the pie in each group that has the GREATER amount and color it yellow.

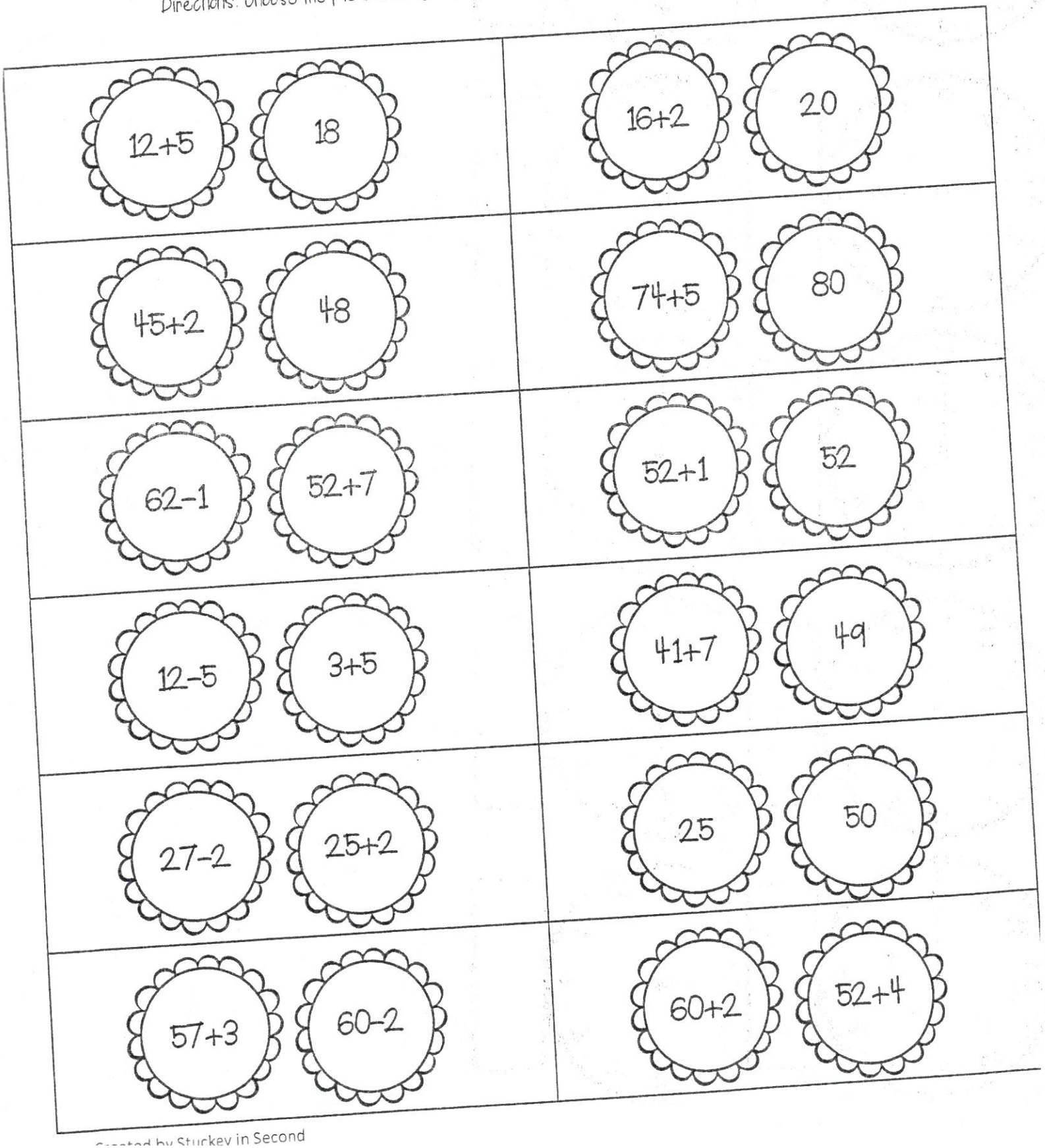

Created by Stuckey in Second

Read to Someone



Characters

Setting

Problem

Solution

Book Title: _____

Author: _____

Me: _____

My Buddy: _____

We give this book this many stars



©seusstastic

Similarities and Differences:

HORSES and UNICORNS





horses

both

unicorns

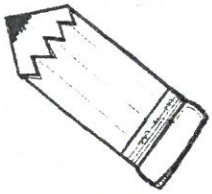

Copyright © 2014 Isla Hearts Teaching

Name: _____ Date: _____

Adding Money Word Problems

Read the word problems, then fill out the number bonds to answer the question. Show your work.

	Number Bond	Work space	Answer
Example: Julia had 65¢. She found the following coins on the ground:  How much does she have now?	? 26¢ 65¢	65 +26 91	91¢
1. Tristan had 74¢. Juniper gave him a quarter. How much does he have now?			
2. Jon had 28¢. He walked the neighbor's dog and earned 25¢. How much does he have now?			

Name: _____ Date: _____

Adding Money Word Problems (continued)

Read the word problems, then fill out the number bonds to answer the question. Show your work.

	Number Bond	Work space	Answer
3. Lula sold one cupcake for 45¢ and one cookie for the coins below. How much did she make in all?			
4. Jayden spent the coins below at a garage sale. How much did he spend in all?			
5. Sophia was given her allowance of 75¢ then found these coins under the couch. How much does she have in all?			

Read to Someone

1st

2nd

3rd

4th

Book Title: _____

Author: _____

Me: _____

My Buddy: _____

We give this book this many stars



©seusstastic

Read to Someone

Characters

Setting

Problem

Solution

Book Title: _____

Author: _____

Me _____

My Buddy _____

We give this book this many stars



©seusstastic

What Happens Next?

Read the story. Decide what might happen next.

Adi's mom asks Adi not to open the window. If he does, bugs might fly into the house. It's very hot inside. Adi opens the window just a little. Then sees a butterfly flying toward the window.



Draw a picture of what you think will happen next.

Write what you think will happen next.

Name_____

Quantity Discrimination Practice #5

Directions: Choose the group of numbers in each box that is the GREATER amount and circle it.

15+6 20	8+8 18
 9+8 9+9 	 7+7 6+6 
 17+4 22 	25 28
85+3 85+2 	 26 20+5
 62+0 63-0	 52+4 58
 19 23-3	 11-5 12-9 

Stuckey in Second ©2015

Name_____

Computation Practice #1



Stuckey in Second ©2015

Name_____

Computation Practice #2



Stuckey in Second ©2015

Name _____

Computation Practice #3



Stuckey in Second ©2015

Name _____

Computation Practice #4



56 + 52	16 + 22	52 + 12	41 + 14
54 − 14	66 − 10	58 − 12	78 − 19
16 + 52	20 + 36	74 + 27	89 + 10
74 − 26	85 − 45	86 − 58	86 − 27

Stuckey in Second ©2015

Name_____

Computation Practice #5





23	59		
+ 29	+ 18		
65	85	79	74
- 14	- 10	- 12	- 19
74	23	56	52
+ 52	+ 36	+ 27	+ 10
42	84	63	85
- 26	- 45	- 36	- 29

Stuckey in Second ©2015

Name_____

Quantity Discrimination Practice #3

Directions: Choose the amount in each group that is GREATER and color the object above it yellow.

32	23	32+1	23+1
12+3	16	16	17+1
52	48+3	45	46+2
23	23+5	47	46+2
47+2	51	62-2	59
64+3	62	51-2	51-3

Stuckey in Second ©2015

Name_____

Missing Number Practice #1

Directions: Look at the numbers on each shamrock, find the pattern, and fill in the missing number.



Stuckey in Second ©2015

Name _____

Number Fact Practice #5

2+4=__	7+8=__	4+6=__	6-5=__
15-8=__	5+4=__	6+6=__	6-3=__
16-7=__	8+5=__	8+7=__	12-4=__
1+6=__	14+2=__	6+5=__	12-1=__
8-4=__	6-3=__	2+2=_	7+2=__
5+4=__			17-2=__
6+1=__			14-3=__
14-8=__			15+4=__

Stuckey in Second ©2015

Name_____

Number Fact Practice #1

































Stuckey in Second ©2015

Name _____

Number Fact Practice #2

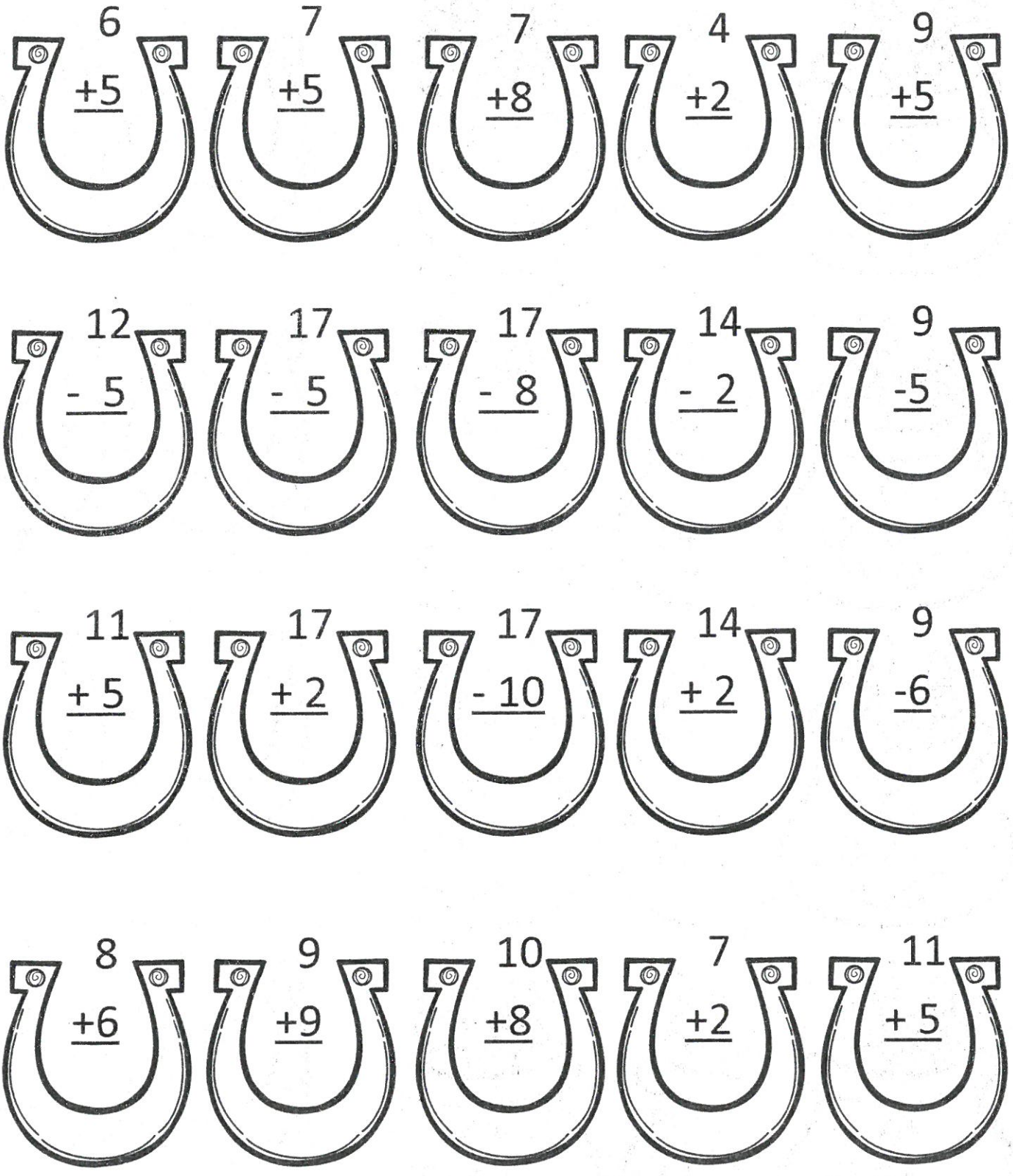

Stuckey in Second ©2015